Représentation Graphique d'une Inéquation (A)

Représentez sur une droite graduée la solution de l'inéquation suivante.

1. $x \leq 3$

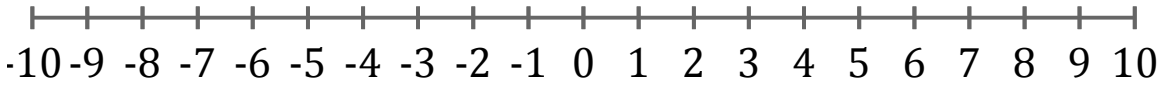

2. $x \geq 0$

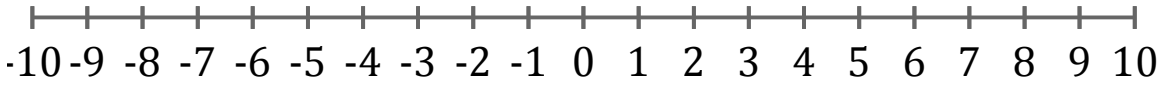

3. $x < 6$

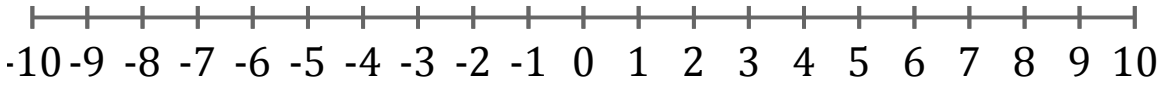

4. $x < -4$

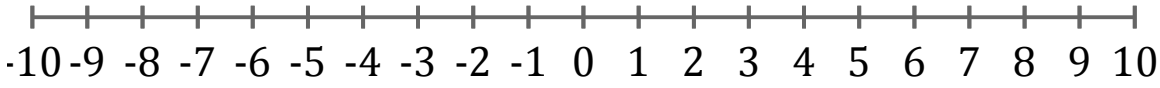
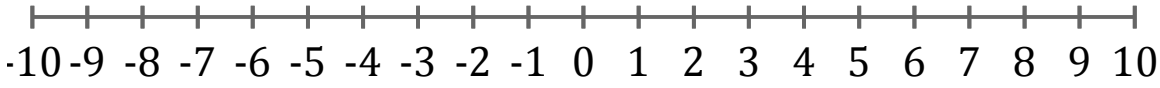
5. $x \leq -8$